Year 1 Maths Activity Mat

③

Section 1

I have 2 pairs of shoes.

How many shoes is that altogether?

Section 2

Shep had 3 dog biscuits.

Rover had 4. How many more biscuits did Rover have?

Section 3

Count the beads and write the number.

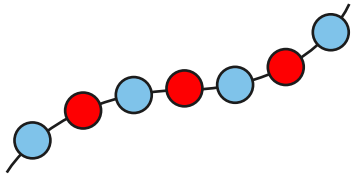

Section 4

I have 16p and I lose 5p.

How much money have I got left?

Section 5

Cut the cake in half.



Section 6

What numbers are missing?

9	8	7	6			3		1

Section 7

What time is it?



5 o'clock ☐

Half past 6 ☐

Half past 5 ☐

Section 8

Complete the number pairs:

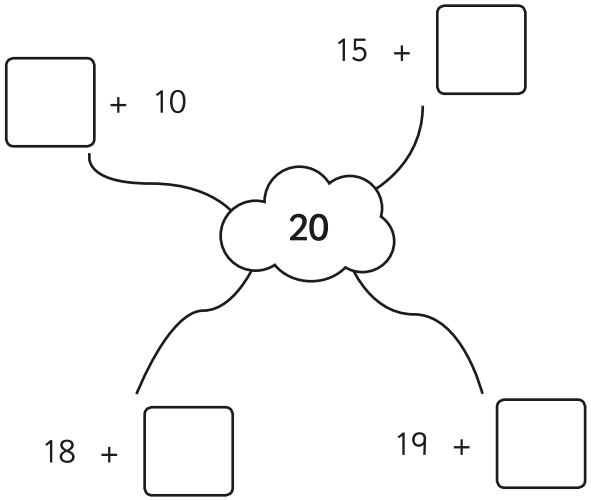

twinkl.co.uk

Year 1 Maths Activity Mat: 3

Answers

Section 1

I have 2 pairs of shoes.

How many shoes is that altogether?

4

Section 2

Shep had 3 dog biscuits.

Rover had 4. How many more biscuits did Rover have?

1

Section 3

Count the beads and write the number.

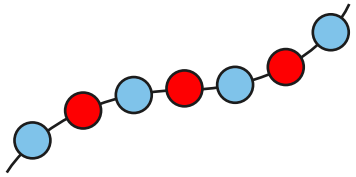

7

Section 4

I have 16p and I lose 5p.

How much money have I got left?

11p

Section 5

Cut the cake in half.

For example:

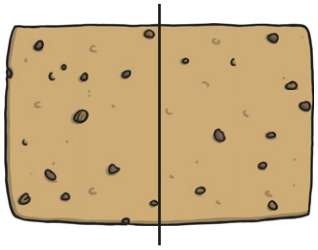

Section 6

What numbers are missing?

9	8	7	6	**5**	**4**	3	**2**	1

Section 7

What time is it?



- 5 o'clock ☐
- Half past 6 ☐
- Half past 5 ☑

Section 8

Complete the number pairs:

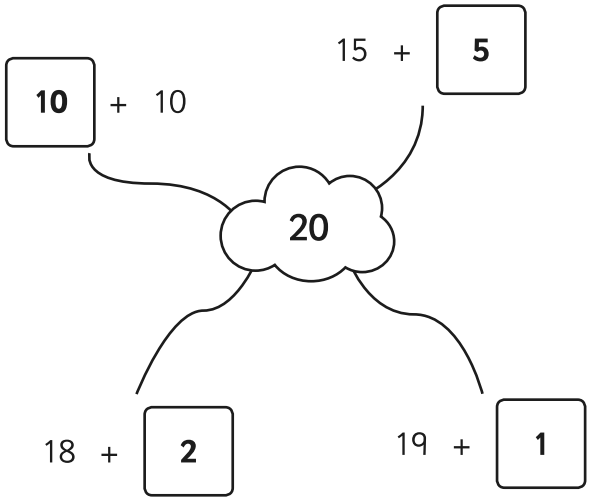

twinkl.co.uk

Year 1 Maths Activity Mat

③

Section 1

I have 3 pairs of shoes.

How many shoes is that altogether?

Section 2

Shep had 3 dog biscuits.

Rover had 5. How many more biscuits did Rover have?

Section 3

Count the beads and write the number.

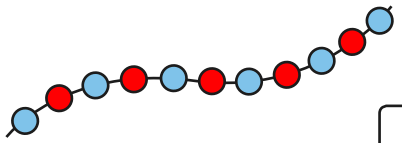

Section 4

I lose 5p from the money pictured below.

How much money have I got left?

Section 5

Cut the cake into quarters.



Section 6

What numbers are missing?

10	8	6			0

Section 7

What time is it?

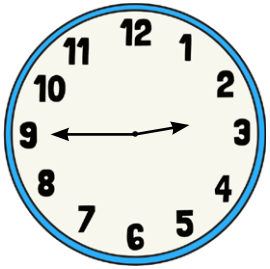

3 o'clock ☐

quarter past 7 ☐

quarter to 3 ☐

Section 8

Complete the number pairs:

☐ + 35

20 + ☐

100

60 + ☐

19 + ☐

twinkl.co.uk

Year 1 Maths Activity Mat: 3

Answers

Section 1

I have 3 pairs of shoes.

How many shoes is that altogether?

6

Section 2

Shep had 3 dog biscuits.

Rover had 5. How many more biscuits did Rover have?

2

Section 3

Count the beads and write the number.

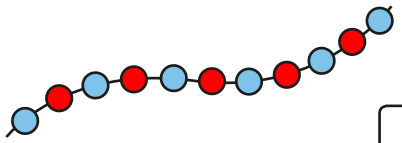

11

Section 4

I lose 5p from the money pictured below.

How much money have I got left?

26p

Section 5

Cut the cake into quarters.

For example:

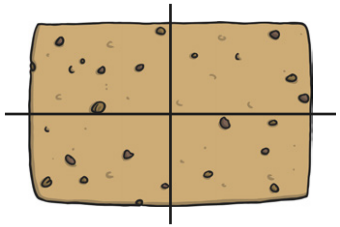

Section 6

What numbers are missing?

10	8	6	**4**	**2**	0

Section 7

What time is it?

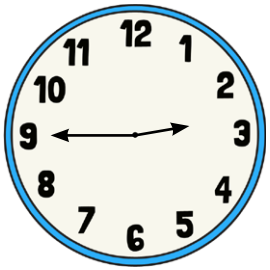

- 3 o'clock ☐
- quarter past 7 ☐
- quarter to 3 ☑

Section 8

Complete the number pairs:

65 + 35

20 + **80**

100

60 + **40**

19 + **81**

twinkl.co.uk

Year 1 Maths Activity Mat

③

Section 1

I have 5 pairs of shoes.

How many shoes is that altogether?

Section 2

Shep had 5 dog biscuits.

Rover had 8. How many more biscuits did Rover have?

Section 3

Count the beads and write the number.

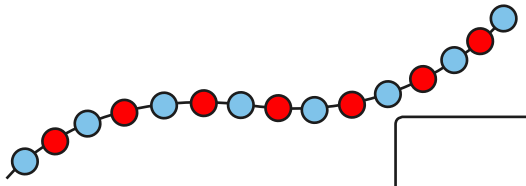

Section 4

I have got 30p.

I lose 5p.

Write this as a number sentence:



Section 5

Cut the cake into quarters.



How many quarters equal a half?

Section 6

What numbers are missing?

40	35	30		20			5	0

Section 7

What time is it?

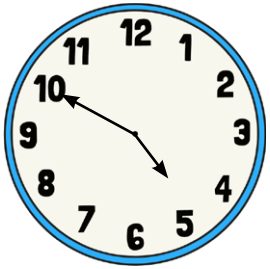

half past 5 ☐

ten to 6 ☐

ten to 5 ☐

Section 8

Complete the number pairs:

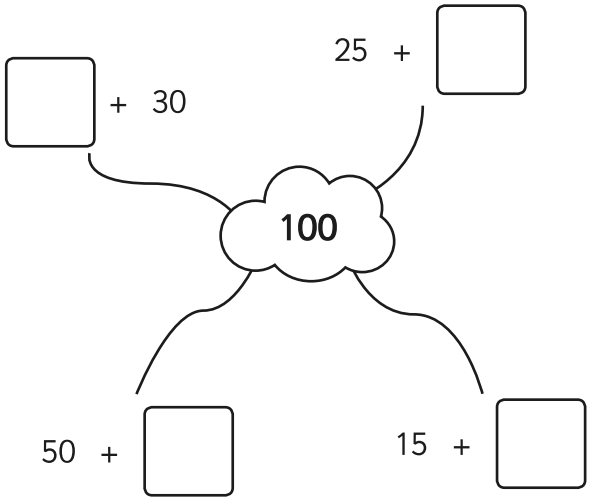

twinkl.co.uk

Year 1 Maths Activity Mat: 3

Answers

Section 1

I have 5 pairs of shoes.

How many shoes is that altogether?

10

Section 2

Shep had 5 dog biscuits.

Rover had 8. How many more biscuits did Rover have?

3

Section 3

Count the beads and write the number.

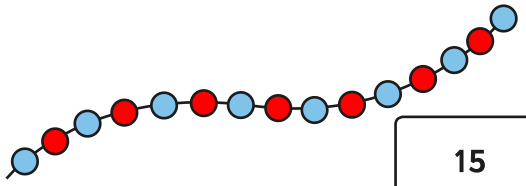

15

Section 4

I have got 30p.

I lose 5p.

Write this as a number sentence:



30 - 5 = 25

Section 5

Cut the cake into quarters.

For example:

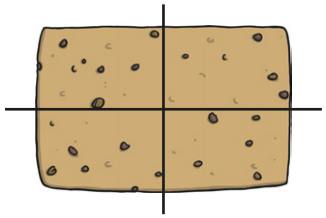

How many quarters equal a half?

2

Section 6

What numbers are missing?

40	35	30	**25**	20	**15**	**10**	5	0

Section 7

What time is it?

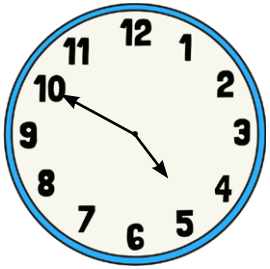

half past 5 ☐

ten to 6 ☐

ten to 5 ☑

Section 8

Complete the number pairs:

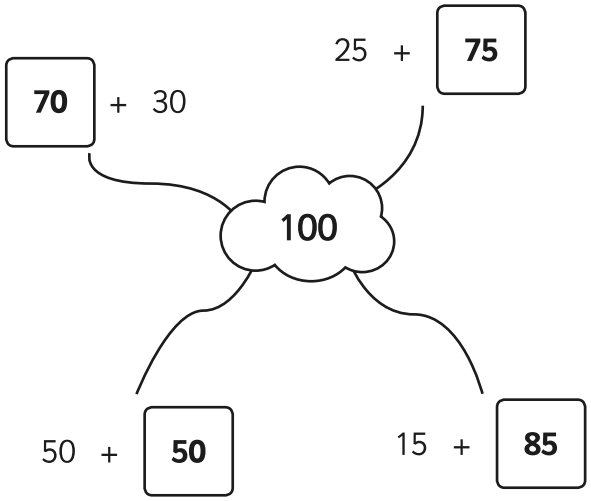

twinkl.co.uk